Name _____

Slope-Intercept Form	Standard Form	x-intercept	y-intercept	Graph
1) $y = \frac{-2}{3}x + 4$				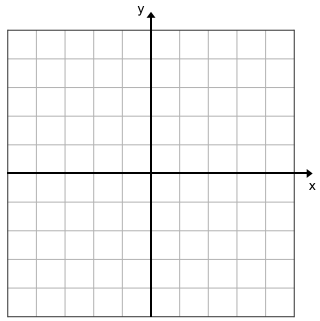
2)		$(-3, 0)$	$(0, 1)$	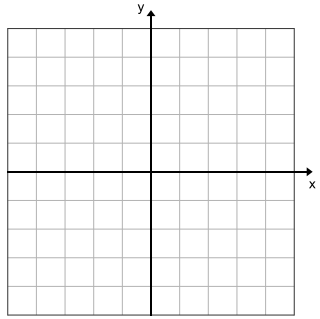
3) $y = -3$				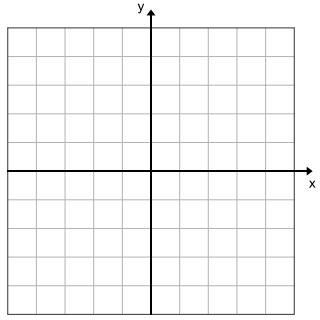

Name _____

Slope-Intercept Form	Standard Form	x-intercept	y-intercept	Graph
4)				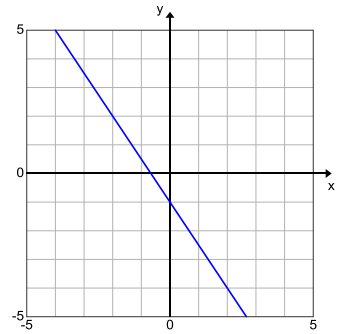
5)	$2x + 3y = -6$			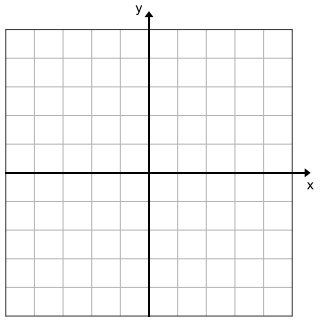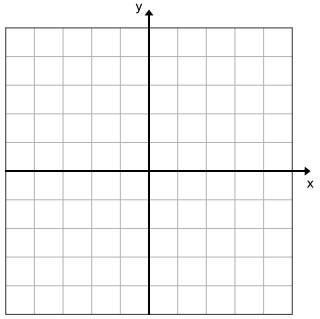
6)		$(2, 0)$	$(0, \frac{-3}{2})$